MEASUREMENT · MATHS · PARENTOVEN.COM

Measure with Cubes

How many cubes long?

Name: _____ Date: _____

LEVEL 2 · MEASURING LENGTH

UKG · Ages 5–6

Count the cubes under each thing. Each thing is exactly as long as the row of cubes under it. Write the number.

A 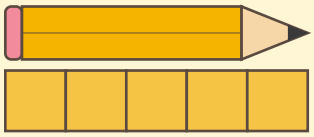 ☐ cubes long

B  ☐ cubes long

C 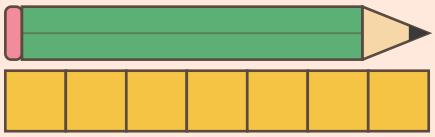 ☐ cubes long

D 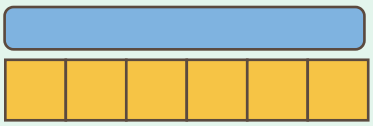 ☐ cubes long

E 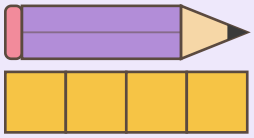 ☐ cubes long

F 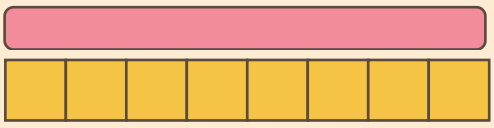 ☐ cubes long

Write the letter.

Which is the longest? ☐ Which is the shortest? ☐

© parentoven.com

Free for home and classroom use